Friday recap:

These next few slides will help your child with recapping what has been taught this week to check that the new learning is consolidated before moving on. There is a slide of guided practice to help with remembering and then a slide of intelligent practice for the children to practice their maths skills.

A bit like an informal test.

Don't worry if something is tricky, go over the lesson that was difficult for the child or send us a message for further help.

Remember to use your resilience and curiosity

Guided practice

I have 3 and 4 . What coin is hidden?

There is a ☐ pence coin hidden.

Guided practice



Intelligent practice

1 Draw a line to show where each coin should go.

Less than 10 pence		Greater than 10 pence

2 Joe has three 10 pound notes, one 20 pound note and two 50 pound notes. Which note is missing?

The _____ note is missing.

3 Count how many there are of each note.



a) There are ☐ 5 pound notes.

b) There are ☐ 10 pound notes.

c) There are ☐ 20 pound notes.

d) There are ☐ 50 pound notes.

Intelligent practice

Answers:

1 Draw a line to show where each coin should go.

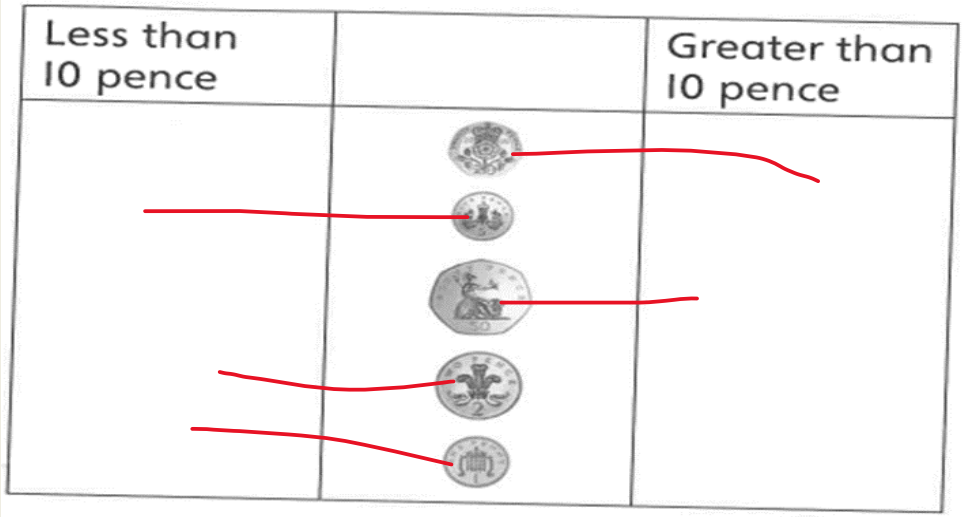

2 Joe has three 10 pound notes, one 20 pound note and two 50 pound notes. Which note is missing?

The £50 pound note is missing.

3 Count how many there are of each note.

a) There are 3 5 pound notes.

b) There are 4 10 pound notes.

c) There are 2 20 pound notes.

d) There are 2 50 pound notes.

Dive deeper 1

Joe, Gregg and Taj each have some money in their pockets.

Joe and Taj both have coins and Gregg has a note.

Taj:



I have more money than Gregg.

I have less money than Gregg.

Joe

What note could Gregg have?

Dive deeper 1

Answers:

Joe, Gregg and Taj each have some money in their pockets.

Joe and Taj both have coins and Gregg has a note.

Taj:



I have more money than Gregg.

I have less money than Gregg.

Joe

What note could Gregg have?

Gregg could have a £5 note.
He could not have a £10 or a £20 note because they are larger than Taj's amount.

Dive deeper 2

Which has the bigger value?

£1 or 100 pence

Explain your answer.

Dive deeper 2

Answers:

Which has the bigger value?

£1 or 100 pence

They are the same. 100p = £1

Explain your answer.

Self-assessment:
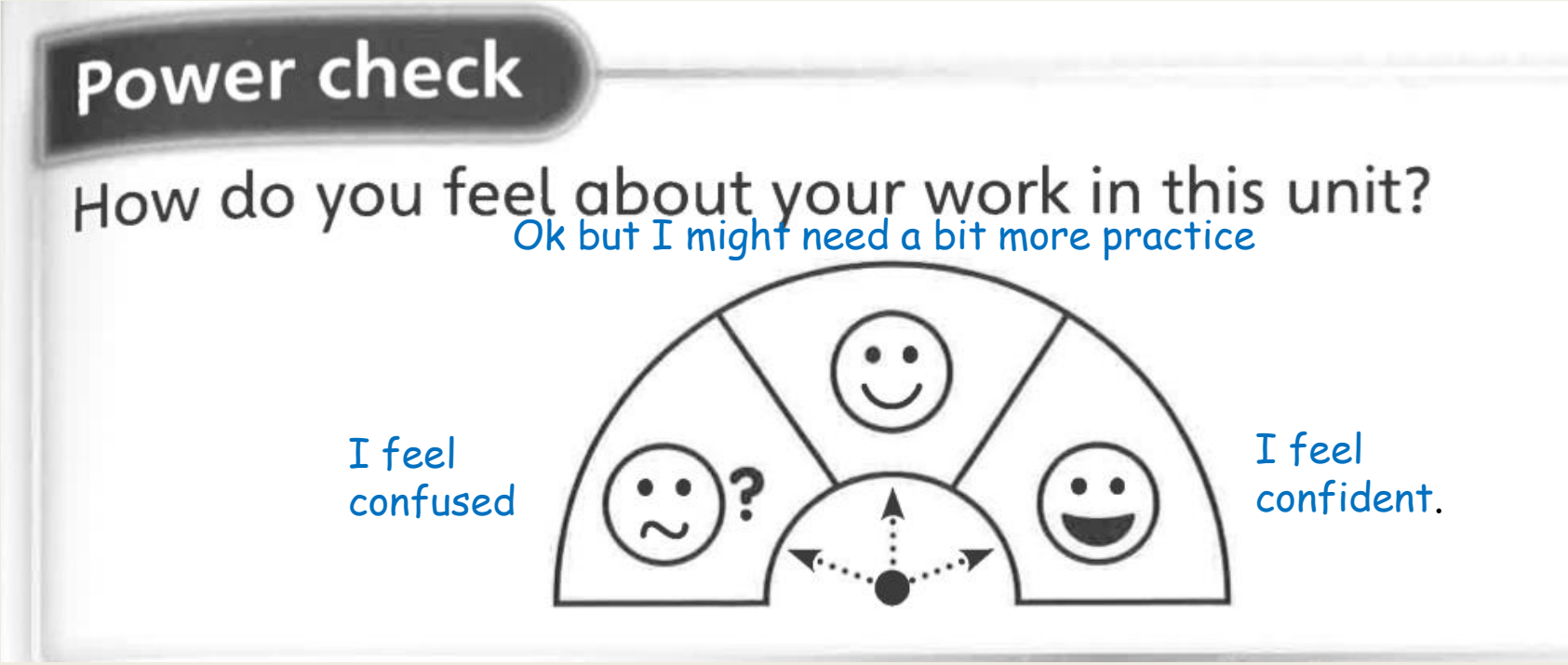
Colour in how you confident you feel with money.